CHAPTER: 1 - Orienting Yourself: The Use of Coordinates

Exercise Set 1.1 (Solution)

Fig. 1.3 shows Reiaan's room with points OABC marking its corners. The x - and y-axes are marked in the figure. Point O is the origin.

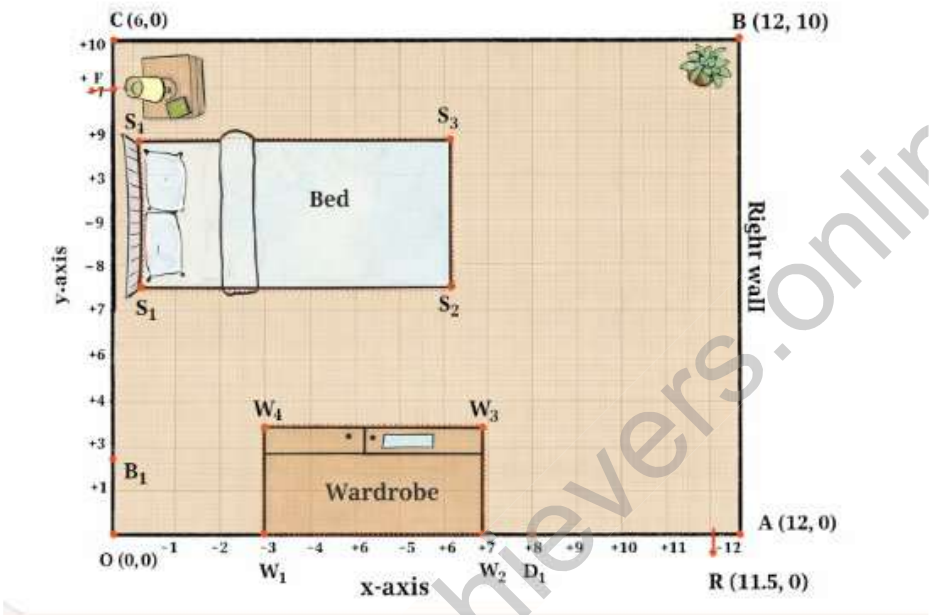

Referring to Fig. 1.3, Answer the following questions:

(i) If D_1R_1 represents the door to Reiaan's room, how far is the door from the left wall (the y-axis) of the room? How far is the door from the x-axis?

Sol.- The room door lies on the x-axis, so its distance from the x-axis $= 0$ units.
From the figure,
$D_1 = (8,0)$ and $R_1 = (11.5,0)$.
So the door begins 8 units from the y-axis.

(ii) What are the coordinates of D_1 ?

Sol.- The coordinates of D1 are $(8,0)$.

(iii) If R_1 is the point ($11.5,0$), how wide is the door? Do you think this is a comfortable width for the room door? If a person in a wheelchair wants to enter the room, will she/he be able to do so easily?

Sol.- Coordinates of $D_1 = (8,0)$ and $R_1 = (11.5,0)$.
So, the width of the door
$=$ distance between D_1 and R_1

www.smartachievers.online

$= 11.5 - 8$
$= 3.5$ units

- ✓ If the unit represents feet, then $3.5\text{ft} \approx 1\text{ mtr}$, which is quite comfortable for a room door.
- ✓ Standard residential doors are usually 0.9 mtr to 1.0 mtr wide, so this is actually slightly wider than average, which is good.

For wheelchair accessibility:

- ✓ A wheelchair typically needs at least 32 inches ($\sim 2.7\text{ft}$) clear width.
- ✓ Since $3.5\text{ft} > 2.7\text{ft}$, the door is wide enough.

So, we can say yes, this door width is comfortable and a person using a wheelchair should be able to enter easily without difficulty.

(iv) If $B_1(0,1.5)$ and $B_2(0,4)$ represent the ends of the bathroom door, is the bathroom door narrower or wider than the room door?

Sol.- Coordinates of $B_1 = (0,1.5)$ and $B_2 = (0,4)$.
So, the width of the bathroom door
$=$ distance between B_1 and B_2= 4 - 1.5 = 2.5 units

Since 2.5 < 3.5, the bathroom door is narrower than the room door.

www.smartachievers.online

Exercise Set 1.2 (Solution)

On a graph sheet, mark the x-axis and y-axis and the origin $\mathbf{O}$. Mark points from $(\mathbf{-7}, \mathbf{0})$ to $(13,0)$ on the x-axis and from $(0, -15)$ to $(0, 12)$ on the y -axis. (Use the scale $1\ \text{cm} = 1$ unit.) Using Fig. 1.5, answer the given questions.

Fig. 1.5

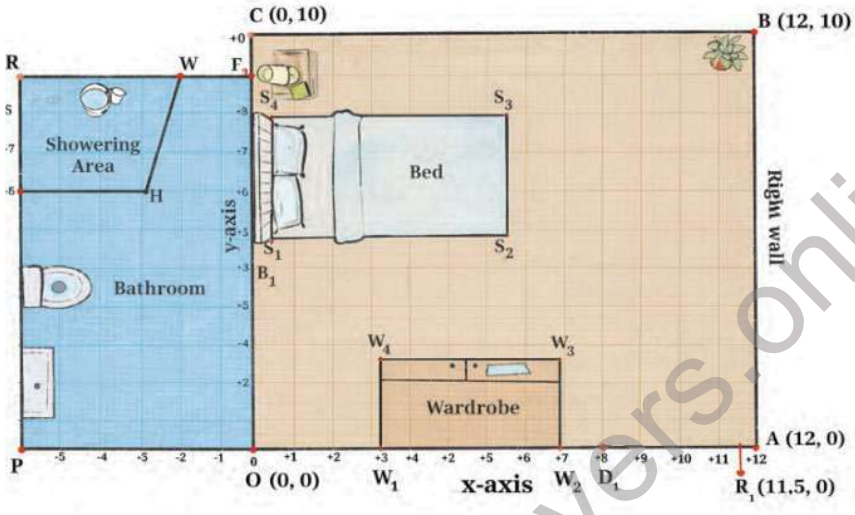

1. Place Reiaan's rectangular study table with three of its feet at the points $(8,9)$, $(11,9)$ and $(11,7)$.

Sol.-

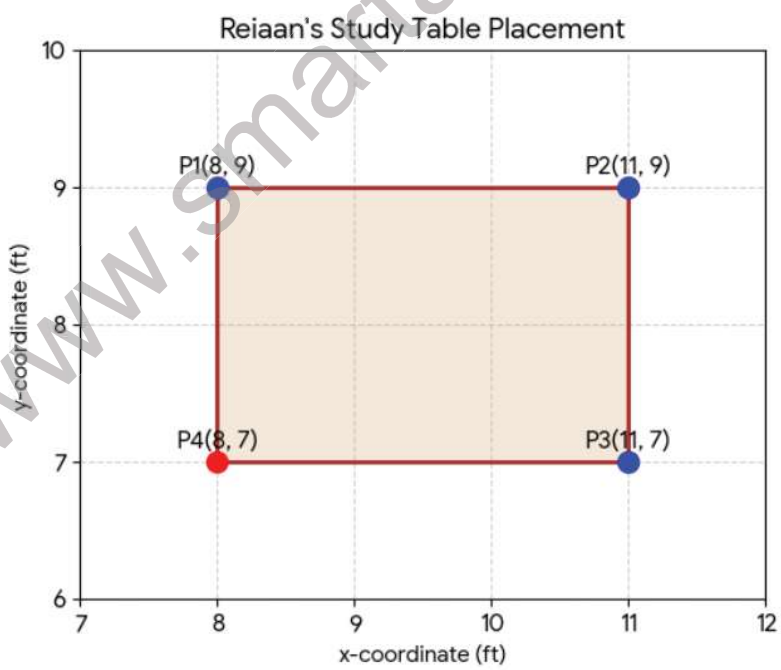

www.smartachievers.online

(i) Where will the fourth foot of the table be?

Sol.- The given three points form three corners of a rectangle:
$A = (8,9)$
$B = (11,9)$
$C = (11,7)$
To complete the rectangle, the fourth point must have:

- ✓ same x-coordinate as $A \rightarrow 8$
- ✓ same y-coordinate as $C \rightarrow 7$

Therefore, the fourth foot is at: $(8,7)$

(ii) Is this a good spot for the table?

Sol.- Yes, this is a good spot because:

- ✓ The table is placed neatly inside the room.
- ✓ It does not block doors or pathways.
- ✓ It is positioned near the wall, which is practical for study.

(iii) What is the width of the table? The length? Can you make out the height of the table?

Sol.- Width:
Distance between $(8,9)$ and $(11,9)$
$= 11 - 8 = 3$ units
Length:
Distance between $(11,9)$ and $(11,7)$
$= 9 - 7 = 2$ units
Height:
The height of the table cannot be determined from the given diagram because the figure represents only a top view (2D), not vertical dimensions.

2. If the bathroom door has a hinge at B_1 and opens into the bedroom, will it hit the wardrobe? Are there any changes you would suggest if the door is made wider?

Sol.- From Fig. 1.5:
$B_1 = (0,1.5)$
$B_2 = (0,4)$
So, the bathroom door has width:
$= 4 - 1.5$
$= 2.5$ units

If the door is hinged at B_1 and opens into the bedroom, it will sweep an arc of radius 2.5 units from B_1.

Now the wardrobe begins at:
$W_1 = (3,0)$ $W_4 = (3,2)$

www.smartachievers.online

The nearest point of the wardrobe from $B_1(0,1.5)$ is around $x = 3$, which is farther than the door width 2.5 units.

Therefore, the bathroom door will not hit the wardrobe.

Suggestion if the door is made wider:

- ✓ If the door becomes much wider, it may come close to or hit the wardrobe.
- ✓ In that case, the door could be made to open inward into the bathroom, or
- ✓ the wardrobe could be shifted slightly to the right or
- ✓ the door width could be kept limited for comfortable movement.

3. Look at Reiaan's bathroom.

(i) What are the coordinates of the four corners $\mathrm{O}, \mathrm{F}, \mathrm{R}$, and P of the bathroom?

Sol.- From Fig. **1.5:**
The coordinates of the four corners $\mathrm{O}, \mathrm{F}, \mathrm{R}$, and P of the bathroom are:
$\mathrm{O} = (0,0)$
$\mathrm{F} = (0,9)$
$\mathrm{R} = (-6,9)$
$P = (-6,0)$

(ii) What is the shape of the showering area SHWR in Reiaan's bathroom? Write the coordinates of the four corners.

Sol.- From the figure:
$\mathrm{S} = (-6,5)$
$\mathrm{H} = (-3,5)$
$\mathrm{W} = (-2,9)$
$\mathrm{R} = (-6,9)$

Since one pair of opposite sides is parallel, SHWR is a trapezium.
Shape of SHWR = Trapezium
Coordinates of the corners:

$$\mathrm{S} = (-6,5), \quad \mathrm{H} = (-3,5)$$
$$\mathrm{W} = (-2,9), \quad \mathrm{R} = (-6,9)$$

(iii) Mark off a $3\text{ft} \times 2\text{ft}$ space for the washbasin and a $2\text{ft} \times 3\text{ft}$ space for the toilet. Write the coordinates of the corners of these spaces.

Sol.- Washbasin space $(3\text{ft} \times 2\text{ft})$:
Take the rectangle at the bottom-left corner of the bathroom.
Coordinates of Corners:
$(-6,0), (-3,0), (-3,2)$ and $(-6,2)$

www.smartachievers.online

Toilet space $(2\text{ft} \times 3\text{ft})$:
Take a rectangle above the washbasin.
Coordinates of Corners:
$(-6,2), (-4,2), (-4,5)$ and $(-6,5)$

Coordinates of Washbasin corners:
$(-6,0), (-3,0), (-3,2)$ and $(-6,2)$

Coordinates of Toilet corners:
$(-6,2), (-4,2), (-4,5)$ and $(-6,5)$

4. Other rooms in the house:

(i) Relaan's room door leads from the dining room which has length 18 ft and width 15 ft . The length of the dining room extends from point P to point A . Sketch the dining room and mark the coordinates of its corners.

Sol.- From Fig. 1.5:
Coordinates of $\mathrm{P} = (-6,0)$
Coordinates of $A = (12,0)$
So, the length of $\mathrm{PA} = 12 - (-6) = 18\text{ft}$, which matches the given length.

If the dining room is 15 ft wide and lies below PA, then its upper side is PA and it extends downward 15 units.

Hence the coordinates of four corners are:

$$P = (-6,0)$$
$$\mathrm{A} = (12,0)$$
$$\mathrm{Q} = (12,-15)$$
$$\mathrm{S} = (-6,-15)$$

The coordinates of the dining room corners are:

$$(-6,0), (12,0), (12,-15), (-6,-15)$$

(ii) Place a rectangular $5\text{ft} \times 3\text{ft}$ dining table precisely in the centre of the dining room. Write down the coordinates of the feet of the table.

Sol.- The dining room extends:
From $\mathrm{x} = -6$ to $\mathrm{x} = 12$
From $\mathrm{y} = 0$ to $\mathrm{y} = -15$
Centre of the dining room:
x-coordinate of centre $= (-6 + 12)/2 = 3$
y-coordinate of centre $= (0 + (-15))/2 = -7.5$
Now place a $5\text{ft} \times 3\text{ft}$ table at the centre.
Taking length $= 5$ units along the x-axis and width $= 3$ units along the y-axis:
Half-length=2.5

www.smartachievers.online

Half-width = 1.5
So the coordinates of corners (feet) of the table are:

- ✓ $(3-2.5, -7.5-1.5) = (0.5, -9)$
- ✓ $(3+2.5, -7.5-1.5) = (5.5, -9)$
- ✓ $(3+2.5, -7.5+1.5) = (5.5, -6)$
- ✓ $(3-2.5, -7.5+1.5) = (0.5, -6)$

The coordinates of the four feet of the dining table are:
$(0.5, -9), (5.5, -9), (5.5, -6), (0.5, -6)$

www.smartachievers.online

End Of Chapter Exercises (Solution)

1. What are the x-coordinate and y-coordinate of the point of intersection of the two axes?

Sol.- The x-axis and y-axis intersect at the origin.
Then x-coordinate $= 0$
Then y -coordinate $= 0$
So, the point of intersection is $(0,0)$.

2. Point W has x-coordinate equal to -5. Can you predict the coordinates of point H which is on the line through W parallel to the y-axis? Which quadrants can H lie in?

Sol.- Point W has **x-coordinate = -5**.

A line parallel to the y-axis means the **x-coordinate remains fixed**.

So any point H on this line will have coordinates of the form:

$$H = (-5, y)$$

where y can be any real number.

- ✓ If $y > 0$, then H lies in Quadrant II.
- ✓ If $y < 0$, then H lies in Quadrant III.
- ✓ If $y = 0$, then H lies on the x-axis.

So, H can lie in:

- ✓ Quadrant II
- ✓ Quadrant III
- ✓ or on the x-axis

www.smartachievers.online

3. Consider the points $\mathrm{R}(3,0), \mathrm{A}(0,-2), \mathrm{M}(-5,-2)$ and $\mathrm{P}(-5,2)$. If they are joined in the same order, predict:

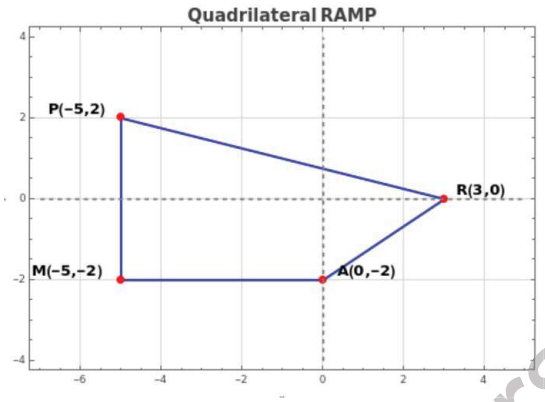

Sol.-

(i) Two sides of RAMP that are perpendicular to each other.

Sol.- we observe from diagram:
AM joins $\mathrm{A}(0,-2)$ to $\mathrm{M}(-5,-2)$, so it is horizontal.
MP joins $\mathrm{M}(-5,-2)$ to $\mathrm{P}(-5,2)$, so it is vertical.
A horizontal line and a vertical line are perpendicular.
Therefore:
$\mathrm{AM} \perp \mathrm{MP}$
The two perpendicular sides are AM and MP.

(ii) One side of RAMP that is parallel to one of the axes.

Sol.- AM is parallel to the x-axis because both points A and M have the same y-coordinate (-2).

MP is parallel to the y-axis because both points M and P have the same x-coordinate (-5).

One side parallel to an axis is:
AM, which is parallel to the x-axis or MP, which is parallel to the y-axis

(iii) Two points that are mirror images of each other in one axis. Which axis will this be?

Now plot the points and verify your predictions.

Sol.- Comparing $\mathrm{M}(-5,-2)$ and $\mathrm{P}(-5,2)$:
They have the same x-coordinate.
Their y-coordinates are equal in magnitude but opposite in sign.

www.smartachievers.online

So, they are mirror images of each other in the x-axis.
The points M and P are mirror images of each other.The axis is the x-axis.

4. Plot point $Z(5, -6)$ on the Cartesian plane. Construct a right-angled triangle IZN and find the lengths of the three sides.
(Comment: Answers may differ from person to person.)

Sol.-

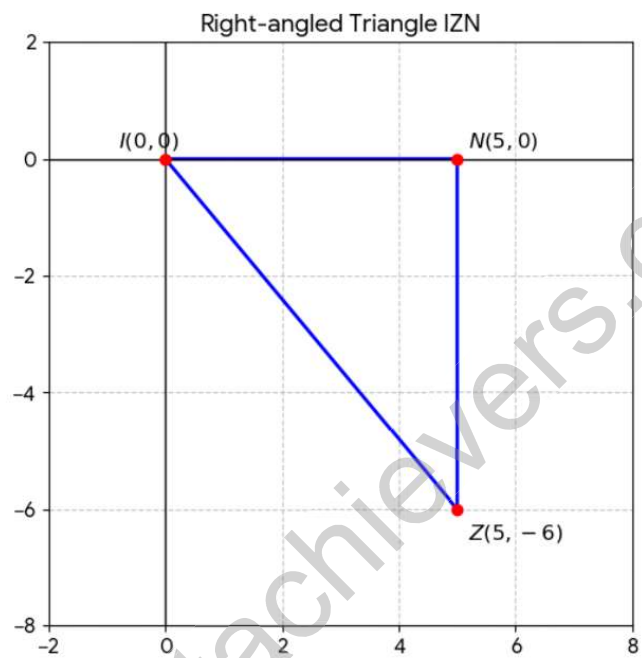

Points I (0, 0), N (5, 0), Z (5, -6)

Find IN (Horizontal side) IN = $\sqrt{((5-0)^2 + (0-0)^2)}$ IN = $\sqrt{(25)}$ IN = 5 units

Find NZ (Vertical side) NZ = $\sqrt{((5-5)^2 + (-6-0)^2)}$ NZ = $\sqrt{(36)}$ NZ = 6 units

Find IZ (Hypotenuse) Using Pythagoras theorem: IZ = $\sqrt{(IN^2 + NZ^2)}$ IZ = $\sqrt{(5^2 + 6^2)}$

IZ = $\sqrt{(25 + 36)}$

IZ = $\sqrt{61} \approx 7.81$ units

Final Answer: IN = 5 units, NZ = 6 units, IZ = $\sqrt{61} \approx 7.81$ units

5. What would a system of coordinates be like if we did not have negative numbers? Would this system allow us to locate all the points on a 2-D plane?

Sol.- If we did not have negative numbers, then coordinates could only be zero or positive. So:

- ✓ On the x-axis, we could mark only the points to the right of the origin.

www.smartachievers.online

- ✓ On the y-axis, we could mark only the points above the origin.

  This means we could locate points only in:

- ✓ Quadrant I
- ✓ the positive part of the x-axis
- ✓ the positive part of the y-axis
- ✓ and the origin

  We would not be able to locate:

- ✓ points in Quadrant II
- ✓ points in Quadrant III
- ✓ points in Quadrant IV
- ✓ points on the negative parts of the axes

Therefore, such a system would not allow us to locate all the points on a 2-D plane.

6. Are the points $\mathrm{M}(-3,-4)$, $\mathrm{A}(0,0)$ and $\mathrm{G}(6,8)$ on the same straight line? Suggest a method to check this without plotting and joining the points.

Sol.- To check whether the points $\mathrm{M}(-3,-4)$, $\mathrm{A}(0,0)$, and $\mathrm{G}(6,8)$ lie on the same straight line using the Distance formula:

$d = \sqrt{[(x_2 - x_1)^2 + (y_2 - y_1)^2]}$

MA $= \sqrt{[(0+3)^2 + (0+4)^2]}$

$= \sqrt{(3^2 + 4^2)}$

$= \sqrt{(9+16)} = \sqrt{25} = 5$

$AG = \sqrt{[(6-0)^2 + (8-0)^2]}$

$= \sqrt{(36+64)}$

$= \sqrt{100} = 10$

$MG = \sqrt{[(6+3)^2 + (8+4)^2]}$

$= \sqrt{(9^2 + 12^2)}$

$= \sqrt{(81+144)}$

$= \sqrt{225} = 15$

Now checking: MA + AG = 5 + 10=15= MG

Since the sum of two distances equals the third, the points M, A and G lie on the same straight Line.

7. Use your method (from Problem 6) to check if the points $\mathrm{R}(-5,-1)$, $\mathrm{B}(-2,-5)$ and $\mathrm{C}(4,-12)$ are on the same straight line.Now plot both sets of points and check your answers.

Sol.- To check whether the points $\mathrm{R}(-5,-1)$, $\mathrm{B}(-2,-5)$ and $\mathrm{C}(4,-12)$ lie on the same straight line using the distance formula: $d = \sqrt{[(x_2 - x_1)^2 + (y_2 - y_1)^2]}$

www.smartachievers.online

$RB = \sqrt{[(-2+5)^2 + (-5+1)^2]}$
$= \sqrt{(3^2 + (-4)^2)}$
$= \sqrt{(9+16)} = \sqrt{25} = 5$
$BC = \sqrt{[(4+2)^2 + (-12+5)^2]}$
$= \sqrt{(6^2 + (-7)^2)}$
$= \sqrt{(36+49)} = \sqrt{85}$
$\mathrm{RC} = \sqrt{[(4+5)^2 + (-12+1)^2]}$
$= \sqrt{(9^2 + (-11)^2)}$
$= \sqrt{(81+121)} = \sqrt{202}$
Now: $RB + BC = 5 + \sqrt{85} \neq \sqrt{202}$
Since the sum of two distances is not equal to the third, the points R, B and C do not lie on the same straight line.

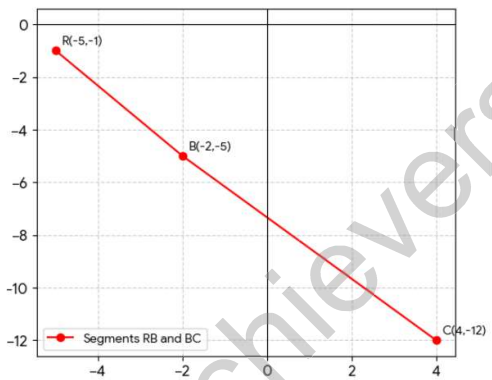

8. Using the origin as one vertex, plot the vertices of:
(i) A right-angled isosceles triangle.
(ii) An isosceles triangle with one vertex in Quadrant III and the other in Quadrant IV.

Sol.- (I)One possible set of vertices of triangle OAB is:
$\mathrm{O} = (0,0)$
$\mathrm{A} = (4,0)$
$B = (0,4)$
Because:
$\mathrm{OA} = 4$ units
$OB = 4$ units
OA is perpendicular to OB
So triangle OAB is a right-angled isosceles triangle.

(iii) An isosceles triangle with one vertex in Quadrant III and the other in Quadrant IV.
One possible set of vertices is:
$\mathrm{O} = (0,0), \mathrm{P} = (-3,-3), \mathrm{Q} = (3,-3)$
Explanation:
P Lies in Quadrant III
Q lies in Quadrant IV

www.smartachievers.online

$OP = OQ = 5$ units
So triangle OPQ is an isosceles triangle.

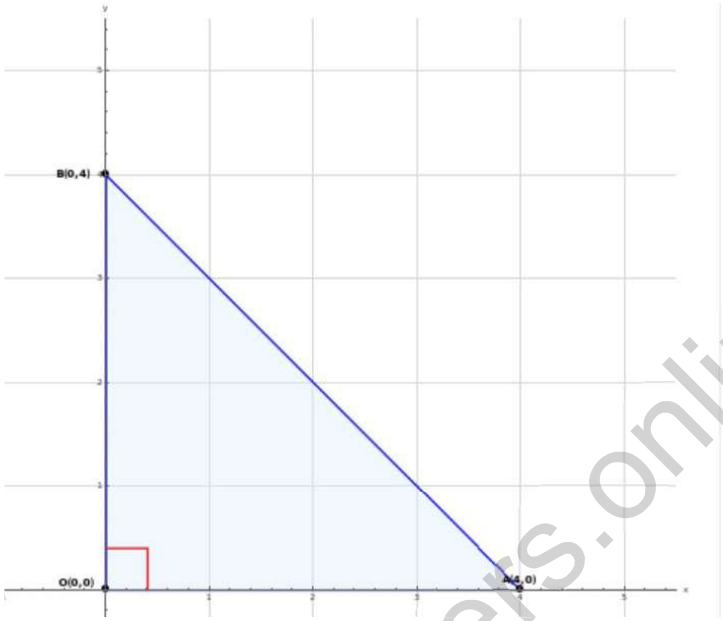

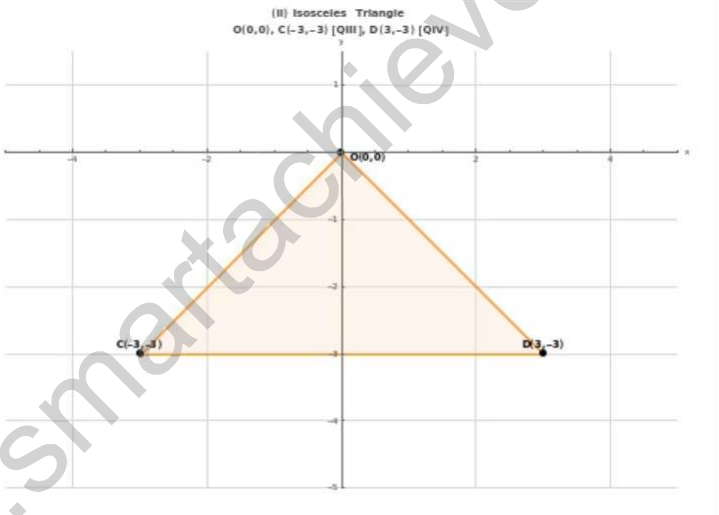

9. The following table shows the coordinates of points S, M and T. In each case, state whether M is the midpoint of segment ST. Justify your answer.

S	M	T	Is M the midpoint of ST? Yes or No	Reason for your answer
(−3, 0)	(0, 0)	(3, 0)		
(2, 3)	(3, 4)	(4, 5)		
(0, 0)	(0, 5)	(0, −10)		
(−8, 7)	(0, −2)	(6, −3)		

www.smartachievers.online

When M is the mid-point of ST, can you find any connection between the coordinates of M, S and T?

Sol.-

Row 1:

S(−3, 0), M(0, 0), T(3, 0)

SM = $\sqrt{(0+3)^2+(0-0)^2}$ = $\sqrt{(3)^2}$ = 3

MT = $\sqrt{(3-0)^2+(0-0)^2}$ = $\sqrt{(3)^2}$ = 3

Since SM = MT

Yes, M is the midpoint.

Row 2:

S(2, 3), M(3, 4), T(4, 5)

SM = $\sqrt{(3-2)^2+(4-3)^2}$ = $\sqrt{(1)^2+(1)^2}$ = $\sqrt{2}$

MT = $\sqrt{(4-3)^2+(5-4)^2}$ = $\sqrt{(1)^2+(1)^2}$ = $\sqrt{2}$

Since SM = MT

Yes, M is the midpoint.

Row 3:

S(0, 0), M(0, 5), T(0, −10)

SM = $\sqrt{(0-0)^2+(5-0)^2}$ = $\sqrt{(5)^2}$ = 5

MT = $\sqrt{(0-0)^2+(-10-5)^2}$ = $\sqrt{(-15)^2}$ = 15

Since SM ≠ MT

No, M is the midpoint.

Row 4:

S(−8, 7), M(0, −2), T(6, −3)

SM = $\sqrt{(0+8)^2+(-2-7)^2}$ = $\sqrt{(8)^2+(-9)^2}$ = $\sqrt{64+81}$= $\sqrt{145}$

MT = $\sqrt{(6-0)^2+(-3+2)^2}$ = $\sqrt{(6)^2+(-1)^2}$ = $\sqrt{36+1}$= $\sqrt{37}$

Since SM ≠ MT

No, M is the midpoint.

Conclusion: When M is the midpoint of ST, then SM = MT.

S	M	T	Is M the midpoint of ST? Yes or No	Reason for your answer
(−3, 0)	(0, 0)	(3, 0)	Yes	SM = MT
(2, 3)	(3, 4)	(4, 5)	Yes	SM = MT
(0, 0)	(0, 5)	(0, −10)	No	SM ≠ MT
(−8, 7)	(0, −2)	(6, −3)	No	SM ≠ MT

www.smartachievers.online

10. Use the connection you found to find the coordinates of B given that M (–7, 1) is the midpoint of A (3, – 4) and B (*x*, *y*).

Sol.-

Given that M(−7, 1) is the midpoint of A(3, −4) and B(x, y).
Using the midpoint relation:

$$M = \left(\frac{x_1 + x_2}{2}, \frac{y_1 + y_2}{2}\right)$$

(-7, 1) = $\left(\frac{3+x}{2}, \frac{-4+y}{2}\right)$
-7 = $\frac{3+x}{2}$ and 1 = $\frac{-4+y}{2}$
-14 = 3 + x and 2 = -4 + y
x = -14 – 3 and y = 2 + 4
x = -17 and y = 6
Therefore, B = (−17, 6).

11. Let P, Q be points of trisection of AB, with P closer to A, and Q closer to B. Using your knowledge of how to find the coordinates of the midpoint of a segment, how would you find the coordinates of P and Q? Do this for the case when the points are A (4, 7) and B (16, –2).

Sol.-

Let A (4, 7) and B (16, –2).
Let P(x_1, y_1) and Q(x_2, y_2) divide AB into three equal parts.
Since P is the midpoint of AQ,

$$x_1 = \frac{4 + x_2}{2} \qquad (1)$$

$$y_1 = \frac{7 + y_2}{2} \qquad (2)$$

Since Q is midpoint of PB,

$$x_2 = \frac{x_1 + 16}{2} \qquad (3)$$

$$y_2 = \frac{y_1 - 2}{2} \qquad (4)$$

Substitute (1) into (3):

www.smartachievers.online

$$x_2 = \frac{\frac{4 + x_2}{2} + 16}{2}$$
$$x_2 = \frac{4 + x_2 + 32}{4} = \frac{x_2 + 36}{4}$$

Multiply both sides by 4:

$$4x_2 = x_2 + 36$$
$$3x_2 = 36 \Rightarrow x_2 = 12$$

Now from (1):

$$x_1 = \frac{4 + 12}{2} = 8$$

Substitute (2) into (4):

$$y_2 = \frac{\frac{7 + y_2}{2} - 2}{2}$$
$$y_2 = \frac{7 + y_2 - 4}{4} = \frac{y_2 + 3}{4}$$

Multiply both sides by 4:

$$4y_2 = y_2 + 3$$
$$3y_2 = 3 \Rightarrow y_2 = 1$$

Now from (2):

$$y_1 = \frac{7 + 1}{2} = 4$$

Hence,
P = (8, 4), Q = (12, 1)

12. (i) Given the points A (1, – 8), B (– 4, 7) and C (–7, – 4), show that they lie on a circle K whose center is the origin O (0, 0). What is the radius of circle K?
(ii) Given the points D (– 5, 6) and E (0, 9), check whether D and E lie within the circle, on the circle, or outside the circle K.

Sol.- (i) OA = $\sqrt{(1)^2 + (-8)^2}$ = $\sqrt{1 + 64}$= $\sqrt{65}$
OB = $\sqrt{()^2 + (7)^2}$ = $\sqrt{16 + 49}$= $\sqrt{65}$
OC = $\sqrt{()^2 + (-4)^2}$ = $\sqrt{49 + 16}$= $\sqrt{65}$
Since,
OA = OB = OC = $\sqrt{65}$
All three points are at the same distance from the origin.
Hence, they lie on a circle with centre O(0, 0).
Radius of circle $K = \sqrt{65}$

(ii) For D (-5, 6):
OD = $\sqrt{(-5)^2 + (6)^2}$= $\sqrt{25 + 36}$= $\sqrt{61}$
Since $\sqrt{61}$< $\sqrt{65}$
∴ D lies inside the circle.
For E (0, 9),
OE = $\sqrt{(0)^2 + (9)^2}$= $\sqrt{81}$= 9

www.smartachievers.online

Since $9 > \sqrt{65}$

∴ E lies outside the circle

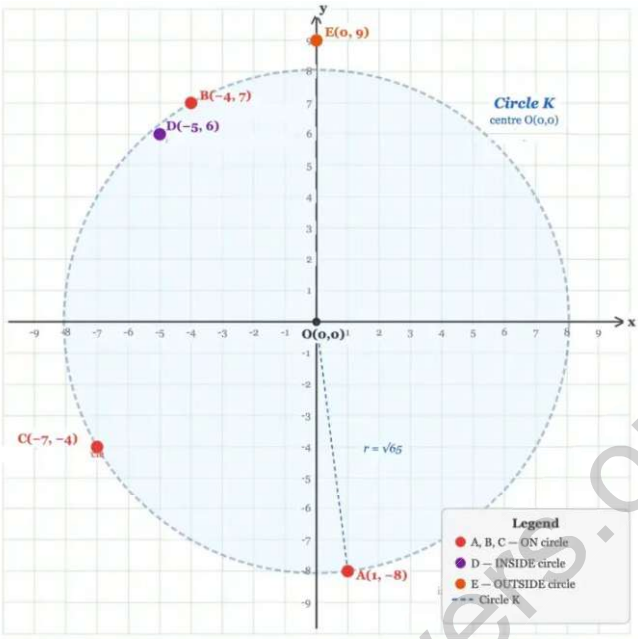

13. The midpoints of the sides of triangle ABC are the points D, E, and F. Given that the coordinates of D, E, and F are (5, 1), (6, 5), and (0, 3), respectively, find the coordinates of A, B, and C.

Sol.-

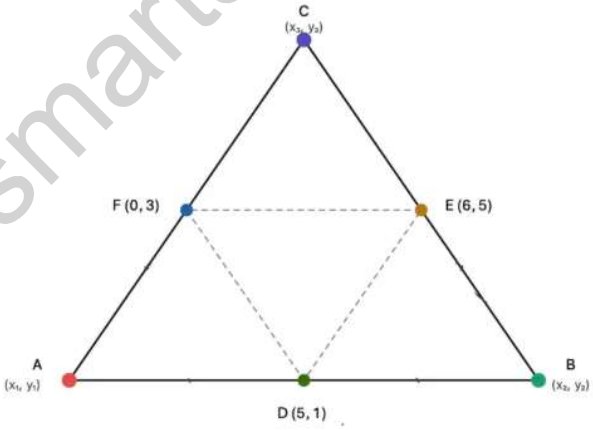

Let $A(x_1, y_1)$, $B(x_2, y_2)$, $C(x_3, y_3)$

Given midpoints: D(5, 1), E(6, 5), F(0, 3)

Using the midpoint formula:

$D = \left(\frac{x_2+x_3}{2}, \frac{y_2+y_3}{2}\right)$

$\Rightarrow (5, 1) = \left(\frac{x_2+x_3}{2}, \frac{y_2+y_3}{2}\right)$

$5 = \frac{x_2+x_3}{2}$ and $1 = \frac{y_2+y_3}{2}$

$x_2 + x_3 = 10$, $y_2 + y_3 = 2$.....(1)

www.smartachievers.online

$E = \left(\frac{x_1+x_3}{2}, \frac{y_1+y_3}{2}\right)$
$\Rightarrow (6, 5) = \left(\frac{x_1+x_3}{2}, \frac{y_1+y_3}{2}\right)$
$6 = \frac{x_1+x_3}{2}$ and $5 = \frac{y_1+y_3}{2}$
$x_1 + x_3 = 12$, $y_1 + y_3 = 10$.....(2)
$F = \left(\frac{x_1+x_2}{2}, \frac{y_1+y_2}{2}\right)$
$\Rightarrow (0, 3) = \left(\frac{x_1+x_2}{2}, \frac{y_1+y_2}{2}\right)$
$0 = \frac{x_1+x_2}{2}$ and $3 = \frac{y_1+y_2}{2}$
$x_1 + x_2 = 0$, $y_1 + y_2 = 6$.....(3)

For x coordinates:
Add (2) and (3):
$(x_1 + x_3) + (x_1 + x_2) = 12 + 0$
$\Rightarrow 2x_1 + x_2 + x_3 = 12$
Using (1): $x_2 + x_3 = 10$
$2x_1 + 10 = 12$
$2x_1 = 12 - 10$
$\Rightarrow x_1 = 1$
From (3): $x_1 + x_2 = 0$
$\Rightarrow 1 + x_2 = 0$
$\Rightarrow x_2 = -1$
From (1): $-1 + x_3 = 10$
$\Rightarrow x_3 = 11$

Now for y-coordinates:
Add (2) and (3):
$(y_1 + y_3) + (y_1 + y_2) = 10 + 6$
$\Rightarrow 2y_1 + y_2 + y_3 = 16$
Using (1): $y_2 + y_3 = 2$
$2y_1 + 2 = 16$
$\Rightarrow y_1 = 7$
From (3): $y_1 + y_2 = 6$
$\Rightarrow 7 + y_2 = 6$
$\Rightarrow y_2 = -1$
From (1): $-1 + y_3 = 2$
$\Rightarrow y_3 = 3$
Therefore, A(1, 7), B(−1, −1), C(11, 3).

14. A city has two main roads which cross each other at the centre of the city. These two roads are along the North–South (N–S) direction and East–West (E–W) direction. All the other streets of the city run parallel to these roads and are 200 m apart. There are 10 streets in each direction.
(i) Using 1 cm = 200 m, draw a model of the city in your notebook. Represent the roads/streets by single lines.
(ii) There are street intersections in the model. Each street intersection is formed by two streets — one running in the N–S direction and another in the E–W direction. Each street

www.smartachievers.online

intersection is referred to in the following manner: If the second street running in the N–S direction and 5th street in the E–W direction meet at some crossing, then we call this street intersection (2, 5). Using this convention, find:
(a) how many street intersections can be referred to as (4, 3).
(b) how many street intersections can be referred to as (3, 4).

Sol.-

(i)

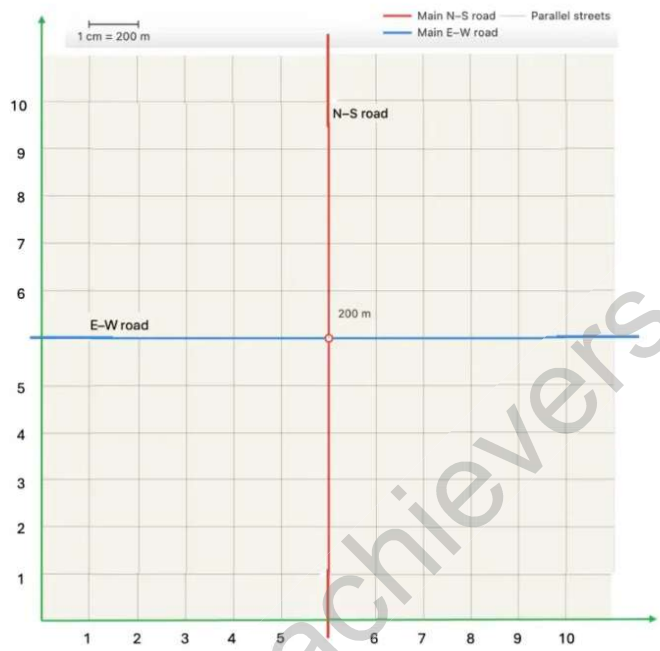

(ii)(a) There is only one intersection where 4th N–S street meets 3rd E–W street, referred as (4, 3).
(b) Similarly, there is only one intersection where 3rd N–S street meets 4th E–W street, referred as (3, 4).

www.smartachievers.online

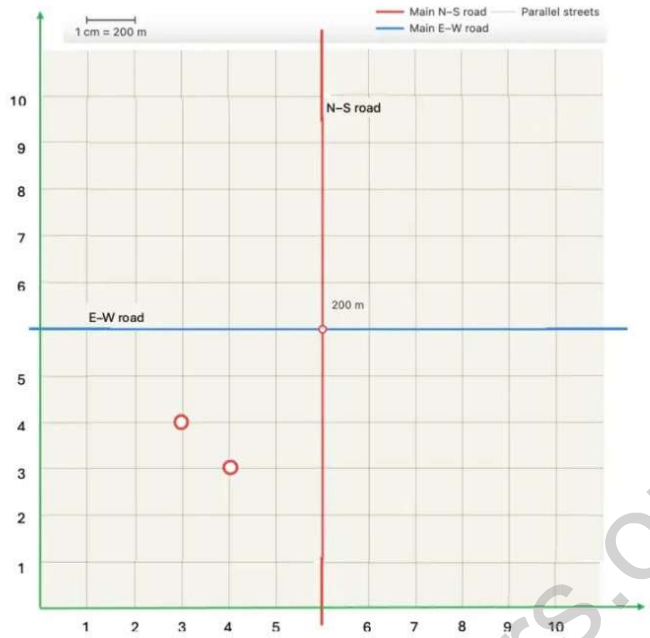

15. A computer graphics program displays images on a rectangular screen whose coordinate system has the origin at the bottom-left corner. The screen is 800 pixels wide and 600 pixels high. A circular icon of radius 80 pixels is drawn with its centre at the point A (100, 150). Another circular icon of radius 100 pixels is drawn with its centre at the point B (250, 230). Determine:

(i) whether any part of either circle lies outside the screen.

(ii) whether the two circles intersect each other.

Sol.-

(i) Both circles lie completely inside the screen.

(ii) Yes, the circles intersect each other.

www.smartachievers.online

16. Plot the points A (2, 1), B (–1, 2), C (–2, –1), and D (1, –2) in the coordinate plane. Is ABCD a square? Can you explain why? What is the area of this square?

Sol.- Plot the points A(2, 1), B(−1, 2), C(−2, −1), D(1, −2) and join them in order.

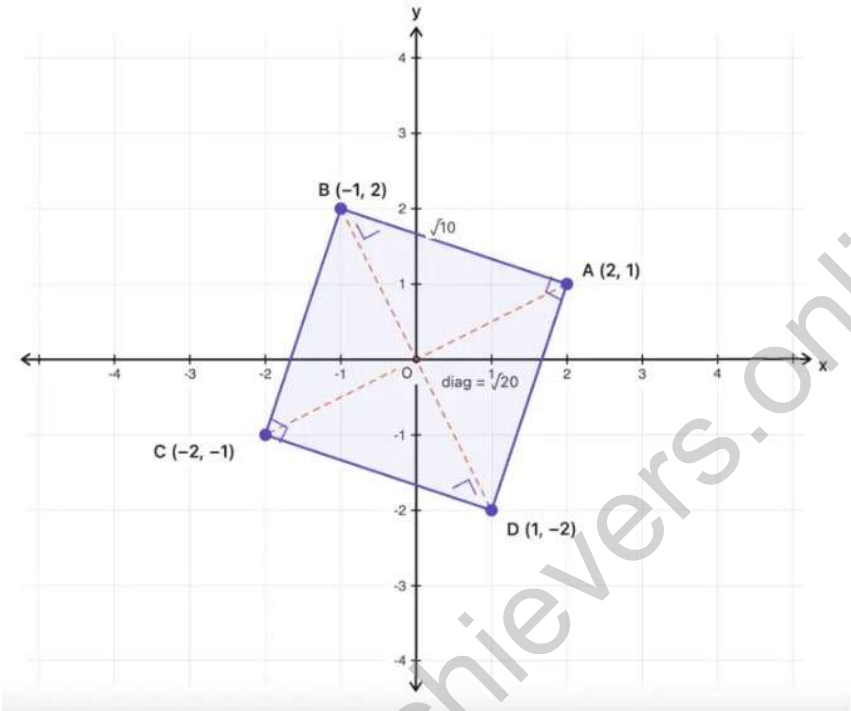

Length of all sides:

AB = $\sqrt{(-1-2)^2+(4-3)^2}$ = $\sqrt{(-3)^2+(1)^2}$ = $\sqrt{9+1}$= $\sqrt{10}$

BC = $\sqrt{(-2+1)^2+(-1-2)^2}$ = $\sqrt{(-1)^2+(-3)^2}$ = $\sqrt{1+9}$= $\sqrt{10}$

CD = $\sqrt{(1+2)^2+(-2+1)^2}$ = $\sqrt{(3)^2+(-1)^2}$ = $\sqrt{9+1}$= $\sqrt{10}$

DA = $\sqrt{(2-1)^2+(1+2)^2}$ = $\sqrt{(1)^2+(3)^2}$ = $\sqrt{1+9}$= $\sqrt{10}$

Length of diagonals:

AC = $\sqrt{(-2-2)^2+(-1-1)^2}$ = $\sqrt{(-4)^2+(-2)^2}$ = $\sqrt{16+4}$= $\sqrt{20}$

BD = $\sqrt{(1+1)^2+(-2-2)^2}$ = $\sqrt{(2)^2+(-4)^2}$ = $\sqrt{4+16}$= $\sqrt{20}$

Since all sides are equal and diagonals are equal,

ABCD is a square.

Side = $\sqrt{10}$

Area = $\sqrt{(10)^2}$= 10 square units.

www.smartachievers.online